60° Angle Worksheet - Solved

Question 1

Identify the vertex in the given figure.

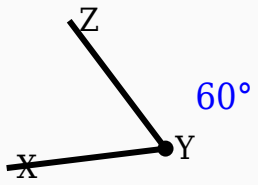

Question 2

60° is an _____ angle.

Question 3

Half of 60° is _____°.

Question 4

60° is greater than 180°.

Question 5

Construct the shown angle using ruler and compass.

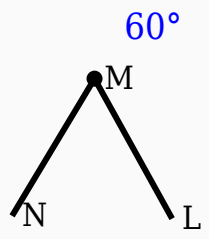

Question 6

Observe the figure and identify the angle.

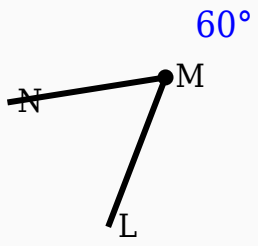

Question 7

60° is a acute angle.

Question 8

60° is greater than _____°.

Question 9

Which instrument is used to measure angles?

A. Divider
B. Protractor
C. Compass
D. Scale

Question 10

60° is an acute angle.

Answer Key

Question	Answer
1	Middle labeled point
2	acute
3	30
4	False
5	60° constructed
6	60°
7	True

8	90
9	Protractor
10	True